AQA

Please write clearly in block capitals.

Centre number | | | | | | Candidate number | | | | |

Surname _____

Forename(s) _____

Candidate signature _____
I declare this is my own work.

GCSE
MATHEMATICS

F

Foundation Tier Paper 1 Non-Calculator

Thursday 16 May 2024 Morning Time allowed: 1 hour 30 minutes

Materials
For this paper you must have:
- mathematical instruments
- the Formulae Sheet (enclosed).

You must **not** use a calculator.



Instructions
- Use black ink or black ball-point pen. Draw diagrams in pencil.
- Fill in the boxes at the top of this page.
- Answer **all** questions.
- You must answer the questions in the spaces provided. Do not write outside the box around each page or on blank pages.
- If you need extra space for your answer(s), use the lined pages at the end of this book. Write the question number against your answer(s).
- Do all rough work in this book. Cross through any work you do not want to be marked.

Information
- The marks for questions are shown in brackets.
- The maximum mark for this paper is 80.
- You may ask for more answer paper, graph paper and tracing paper. These must be tagged securely to this answer book.

Advice
In all calculations, show clearly how you work out your answer.

For Examiner's Use	
Pages	Mark
2–3	
4–5	
6–7	
8–9	
10–11	
12–13	
14–15	
16–17	
18–19	
20–21	
22–23	
24–25	
TOTAL	

Do not write outside the box

Answer **all** questions in the spaces provided.

1 (a) Work out $280 \div 7$

[1 mark]

Answer _____

1 (b) Work out $1062 - 438$

[2 marks]

Answer _____

Do not write outside the box

2 (a) Complete the statement.

[1 mark]

2 metres = _____ centimetres

2 (b) Complete the statement.

[1 mark]

8 kilograms = _____ grams

2 (c) Convert 24 kilometres to miles.

Use 8 kilometres = 5 miles

[2 marks]

Answer _____ miles

7

Turn over ►

Do not write outside the box

3 (a) Here is a centimetre grid.

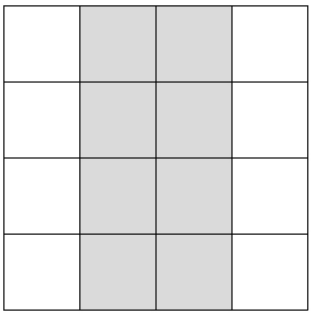

What **percentage** of the grid is shaded?

[1 mark]

Answer _____ %

3 (b) Kai has shaded two small squares on this centimetre grid.

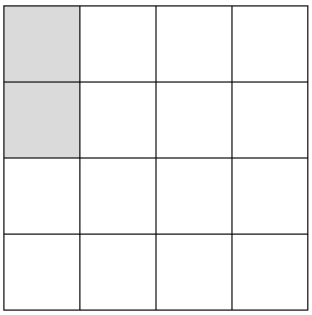

He wants $\frac{3}{4}$ of the grid to be shaded.

How many **more** small squares must he shade?

[2 marks]

_____

_____

Answer _____

Do not write outside the box

4 (a) Here is a list of four numbers.

6.92 7.27 7.18 7.14

Use **one** number from the list to complete each statement.

[2 marks]

The number closest in value to 7 is _____

The number that rounds to 7.2 to 1 decimal place is _____

4 (b) Here is a list of six numbers.

–10 –5 –2 4 6 10

Use **two** numbers from the list to complete each statement.

[2 marks]

Two numbers that **add** to make –1 are _____ and _____

Two numbers that **multiply** to make 20 are _____ and _____

Turn over for the next question

7

Do not write outside the box

5 (a) Here are four lines on a square grid.

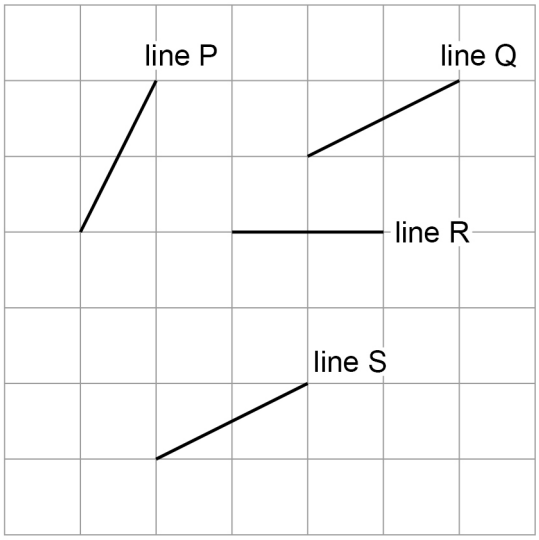

Which **two** lines are parallel?

[1 mark]

line _____ and line _____

5 (b) Here is a different grid.

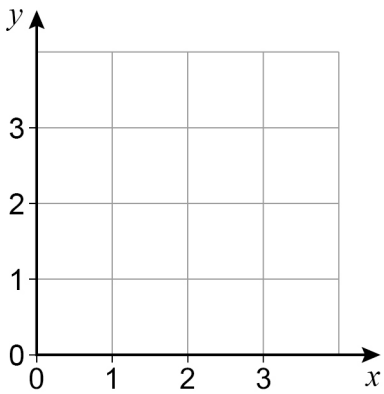

There are **four** points on this grid that each have

both coordinates that are whole numbers

and

x-coordinate + y-coordinate = 3

Plot the **four** points on the grid.

[2 marks]

Do not write outside the box

6 (a) Write down the value of 3^2

[1 mark]

Answer _____

6 (b) Write down the value of $\sqrt{144}$

[1 mark]

Answer _____

6 (c) Work out the value of 2^4

[1 mark]

_____

_____

_____

Answer _____

Turn over for the next question

6

Do not write outside the box

7 (a) At a restaurant, vegan pizzas have two **different** toppings.

The toppings are

sweetcorn (S) mushrooms (M) peppers (P)

Complete the table to list all the possible pairs of toppings.

[1 mark]

SM

7 (b) At the restaurant, dough balls can be ordered in small portions and large portions.

Small portion
6 dough balls

Large portion
10 dough balls

A group of people want to order **exactly** 44 dough balls.

Show how they can do this.

[2 marks]

Number of Small portions _____

Number of Large portions _____

Do not write outside the box

8

Apples	25p each
Oranges	60p each

Salma has £10 to buy apples and oranges.

She buys

9 apples

and

as many oranges as possible.

How many oranges does she buy?

[4 marks]

Answer _____

7

Turn over ►

Do not write outside the box

9 Alina and Sue play netball.

The number of goals they scored in 8 games is shown.

Alina	12	15	17	17	21	22	24	26
Sue	13	13	17	20	22	23	24	31

9 (a) Complete this table.

[2 marks]

	Range	**Median**
Alina		19
Sue	18	

9 (b) Which player scored the more consistent number of goals?

Tick a box.

Alina ☐ Sue ☐

Give a reason for your answer.

[1 mark]

Do not write outside the box

10 Work out 35% of 1200

[3 marks]

Answer _____

Turn over for the next question

6

Do not write outside the box

11 A window cleaner uses this formula.

$$C = 2W + 5$$

C = cost, in £, for the customer

W = number of windows to be cleaned

11 (a) How much does it cost for 6 windows to be cleaned?

[2 marks]

Answer £ _____

11 (b) The cost for another customer was £24

Show why this cost **must** be incorrect.

[1 mark]

Do not write outside the box

12 Two bags, X and Y, each contain coloured discs.

In bag X, $\frac{7}{20}$ of the discs are red.

In bag Y, $\frac{2}{5}$ of the discs are red.

Which bag has the **greater** proportion of red discs, X or Y?

You **must** show your working.

[2 marks]

Answer _____

Turn over for the next question

5

Do not write outside the box

13 (a) Two friends share £240 in the ratio 1 : 3

Work out the larger share.

[2 marks]

Answer £ _____

13 (b) A tennis player wins or loses matches in the ratio win : lose = 5 : 9

What fraction of the matches do they win?

[1 mark]

Answer _____

Do not write outside the box

14 Here is a multiplication table.

×	**61**	**63**	**65**	**67**
61	3721	3843	3965	4087
63	3843	3969	4095	4221
65	3965	4095	4225	4355
67	4087	4221	4355	4489

Use the table to answer the following questions.

14 (a) Work out $3843 \div 63$

[1 mark]

Answer _____

14 (b) Work out 6.1×6.7

[1 mark]

Answer _____

14 (c) Work out 63×66

[2 marks]

_____

_____

_____

_____

Answer _____

7

Turn over ►

Do not write outside the box

15 These two triangles are **congruent**.

Not drawn accurately

Write down the value of x.

[1 mark]

$x =$ _____ cm

16 c and d are positive numbers.

c is even.

d is odd.

Tick a box for each expression.

[3 marks]

	Even	**Odd**	**Cannot tell**
$c + d$	☐	☐	☐
$4c$	☐	☐	☐
$\frac{c}{2}$	☐	☐	☐

Do not write outside the box

17 A linear sequence has

- 1st term = 10
- 1st term + 2nd term = 39

Work out the 5th term.

[4 marks]

Answer _____

18

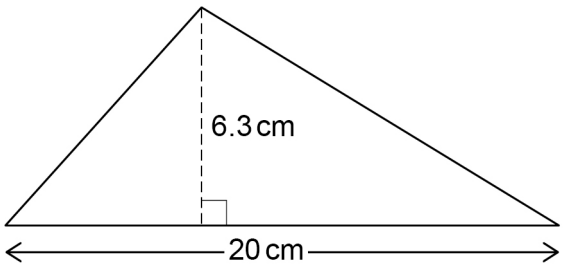

Not drawn accurately

Work out the area of this triangle.

[2 marks]

Answer _____ cm^2

10

Turn over ►

Do not write outside the box

19 The vector $\begin{pmatrix} -3 \\ 7 \end{pmatrix}$ translates A to B.

Write down the vector that translates B to A.

[1 mark]

Answer $\begin{pmatrix} \quad \\ \quad \end{pmatrix}$

20 The attendance for a rugby match is 8400 people to the nearest 100

20 (a) Write down the minimum possible attendance.

[1 mark]

Answer _____

20 (b) Write down the maximum possible attendance.

[1 mark]

Answer _____

Do not write outside the box

21 The table shows the number of workers at a company in different years.

Year	2015	2016	2017	2018	2019	2020	2021	2022
Number of workers	29	34	42	52	62	70	76	80

A time-series graph is drawn to represent the data.

The first four points have been plotted.

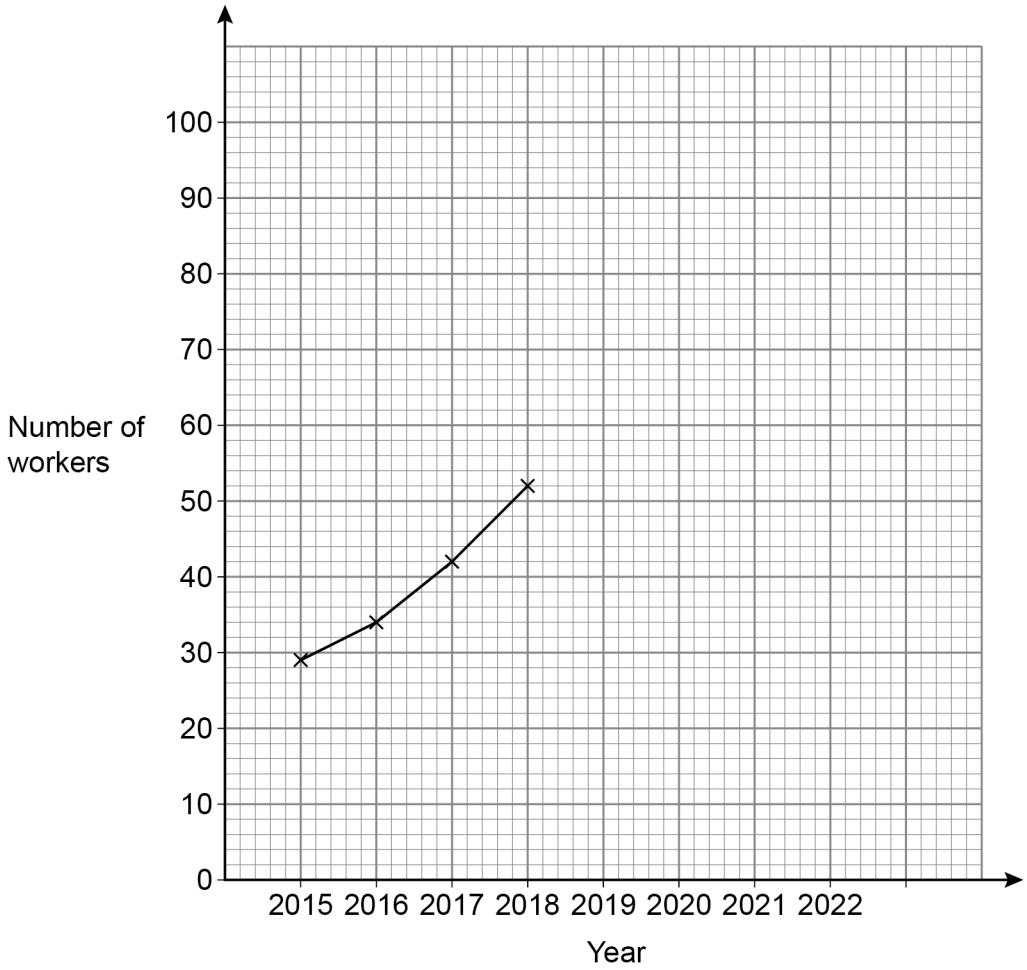

21 (a) Complete the graph.

[2 marks]

21 (b) Estimate the number of workers at the company in 2023.

[1 mark]

Answer _____

6

Turn over ►

Do not write outside the box

22 Here is a cone.

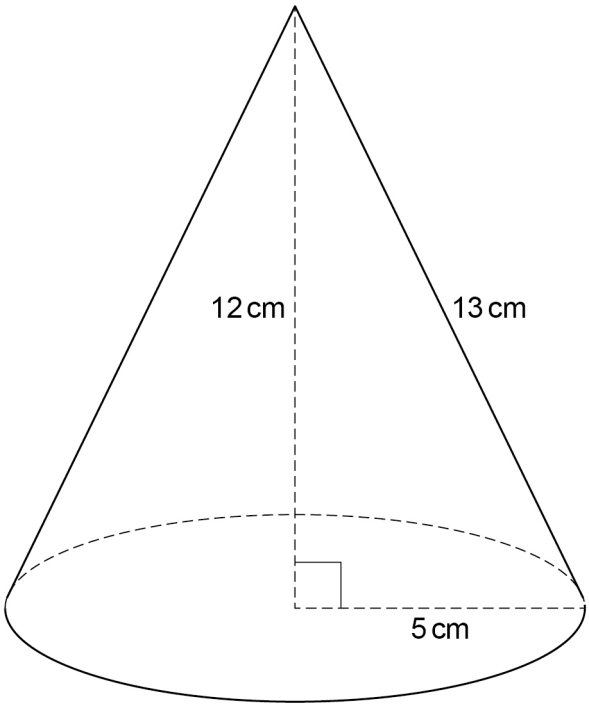

22 (a)

Curved surface area of a cone = πrl
where r is the radius and l is the slant height

Beth tries to work out the curved surface area in terms of π

Curved surface area of the cone = $\pi \times 5 \times 12$
$= 60\pi \text{ cm}^2$

What mistake has she made?

[1 mark]

Do not write outside the box

22 (b) Adam uses $\pi = 3$ to estimate the area of the **base** of the cone.

Work out his estimate.

[2 marks]

Answer _____ cm^2

22 (c) Beth uses $\pi = 3.14$ to estimate the area of the **base** of the cone.

Is Beth's estimate more than or less than Adam's estimate?

Tick a box.

More than ☐ Less than ☐

Give a reason for your answer.

[1 mark]

Turn over for the next question

4

Do not write outside the box

23 Each day, Erik drinks

$\frac{1}{4}$ of a pint of milk in the morning

and

$\frac{1}{2}$ of a pint of milk in the afternoon.

How many pints of milk does he drink in 30 days?

[3 marks]

Answer _____

Do not write outside the box

24 Solve $7x - 22 = 4x + 29$

[3 marks]

$x =$ _____

25 In a house

the floor area of the living room is $26\,\text{m}^2$

the floor area of the kitchen is $16.4\,\text{m}^2$

Express the area of the living room as a fraction of the area of the kitchen.

Give your answer in its simplest form.

[3 marks]

Answer _____

9

Do not write outside the box

26 (a) Represent $-2 < x < 4$ on the number line.

[1 mark]

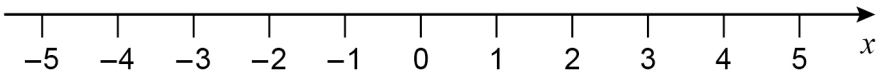

26 (b) Solve $5y + 14 \geqslant 11$

[2 marks]

Answer _____

Do not write outside the box

27

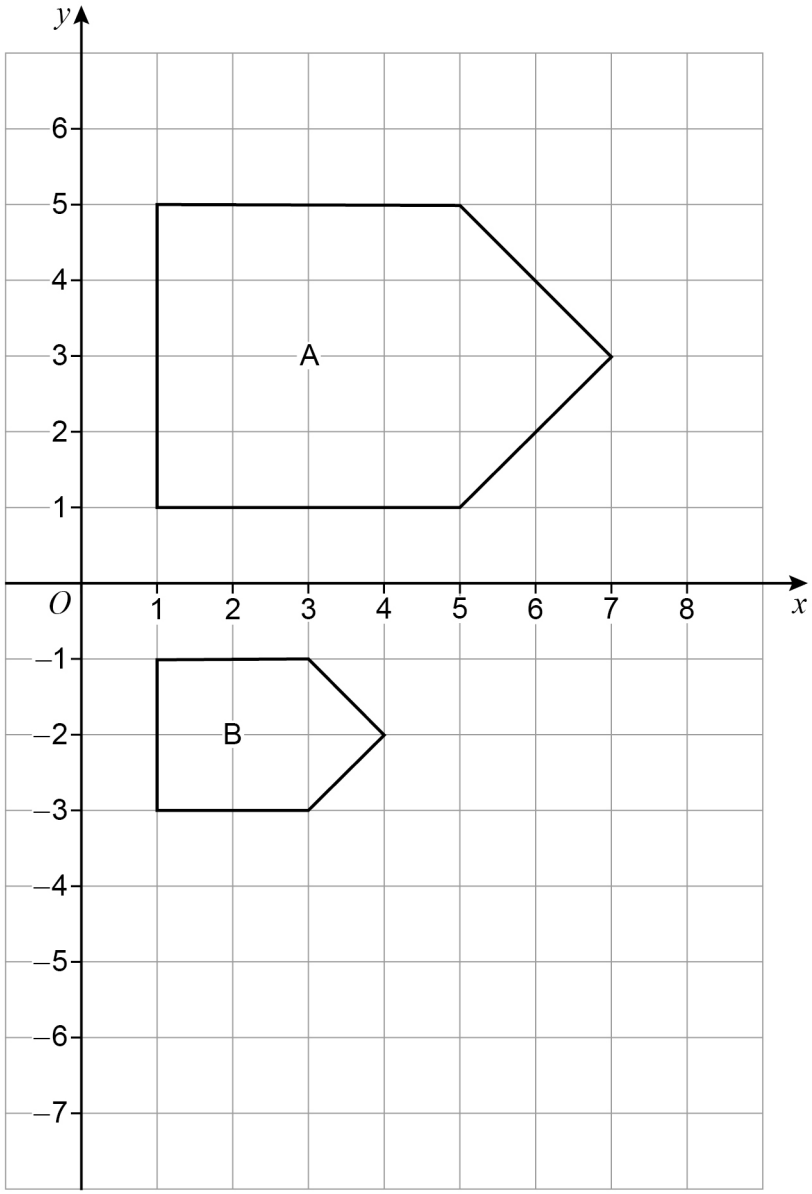

Describe fully the **single** transformation that maps shape A to shape B.

[3 marks]

END OF QUESTIONS

6

Do not write outside the box

There are no questions printed on this page

DO NOT WRITE ON THIS PAGE
ANSWER IN THE SPACES PROVIDED

Do not write outside the box

Question number	**Additional page, if required.** **Write the question numbers in the left-hand margin.**

Do not write outside the box

Question number	**Additional page, if required.** **Write the question numbers in the left-hand margin.**

Copyright information

For confidentiality purposes, all acknowledgements of third-party copyright material are published in a separate booklet. This booklet is published after each live examination series and is available for free download from www.aqa.org.uk.

Permission to reproduce all copyright material has been applied for. In some cases, efforts to contact copyright-holders may have been unsuccessful and AQA will be happy to rectify any omissions of acknowledgements. If you have any queries please contact the Copyright Team.

Copyright © 2024 AQA and its licensors. All rights reserved.