AQA

Please write clearly in block capitals.

Centre number | | | | | | Candidate number | | | | |

Surname _____

Forename(s) _____

Candidate signature _____
I declare this is my own work.

GCSE
MATHEMATICS

H

Higher Tier Paper 1 Non-Calculator

Thursday 16 May 2024 Morning Time allowed: 1 hour 30 minutes

Materials
For this paper you must have:
- mathematical instruments
- the Formulae Sheet (enclosed).

You must **not** use a calculator.

Instructions
- Use black ink or black ball-point pen. Draw diagrams in pencil.
- Fill in the boxes at the top of this page.
- Answer **all** questions.
- You must answer the questions in the spaces provided. Do not write outside the box around each page or on blank pages.
- If you need extra space for your answer(s), use the lined pages at the end of this book. Write the question number against your answer(s).
- Do all rough work in this book. Cross through any work you do not want to be marked.

Information
- The marks for questions are shown in brackets.
- The maximum mark for this paper is 80.
- You may ask for more answer paper, graph paper and tracing paper. These must be tagged securely to this answer book.

Advice
In all calculations, show clearly how you work out your answer.

For Examiner's Use	
Pages	Mark
2–3	
4–5	
6–7	
8–9	
10–11	
12–13	
14–15	
16–17	
18–19	
20–21	
22–23	
24	
TOTAL	

Do not write outside the box

Answer **all** questions in the spaces provided.

1 Work out $12^2 \div \left(\frac{1}{3} \times \sqrt{36}\right)$

[3 marks]

Answer _____

2 Measure the **shortest** distance from point *P* to the line.

Give your answer in millimetres.

[1 mark]

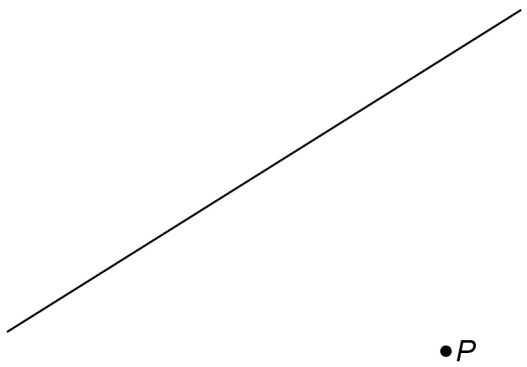

Answer _____ mm

Do not write outside the box

3 The vector $\begin{pmatrix} -3 \\ 7 \end{pmatrix}$ translates A to B.

Write down the vector that translates B to A.

[1 mark]

Answer $\begin{pmatrix} \quad \\ \quad \end{pmatrix}$

4 The attendance for a rugby match is 8400 people to the nearest 100

4 (a) Write down the minimum possible attendance.

[1 mark]

Answer _____

4 (b) Write down the maximum possible attendance.

[1 mark]

Answer _____

Turn over for the next question

7

Do not write outside the box

5 A school year has 78 students.

28 wear glasses.

$\frac{1}{4}$ of the students who wear glasses are left-handed.

30% of the students who do **not** wear glasses are left-handed.

5 (a) ξ = students in the school year

G = wears glasses

L = left-handed

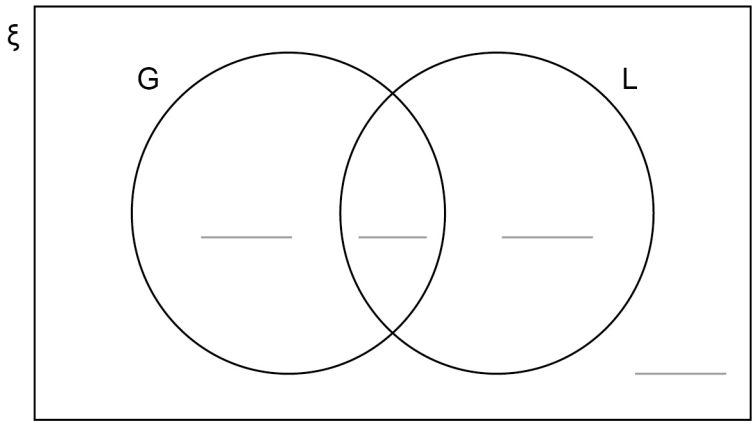

Complete the Venn diagram.

[3 marks]

5 (b) A left-handed student is chosen at random.

Work out the probability that the student wears glasses.

[1 mark]

Answer _____

Do not write outside the box

6 The table shows the number of workers at a company in different years.

Year	2015	2016	2017	2018	2019	2020	2021	2022
Number of workers	29	34	42	52	62	70	76	80

A time-series graph is drawn to represent the data.

The first four points have been plotted.

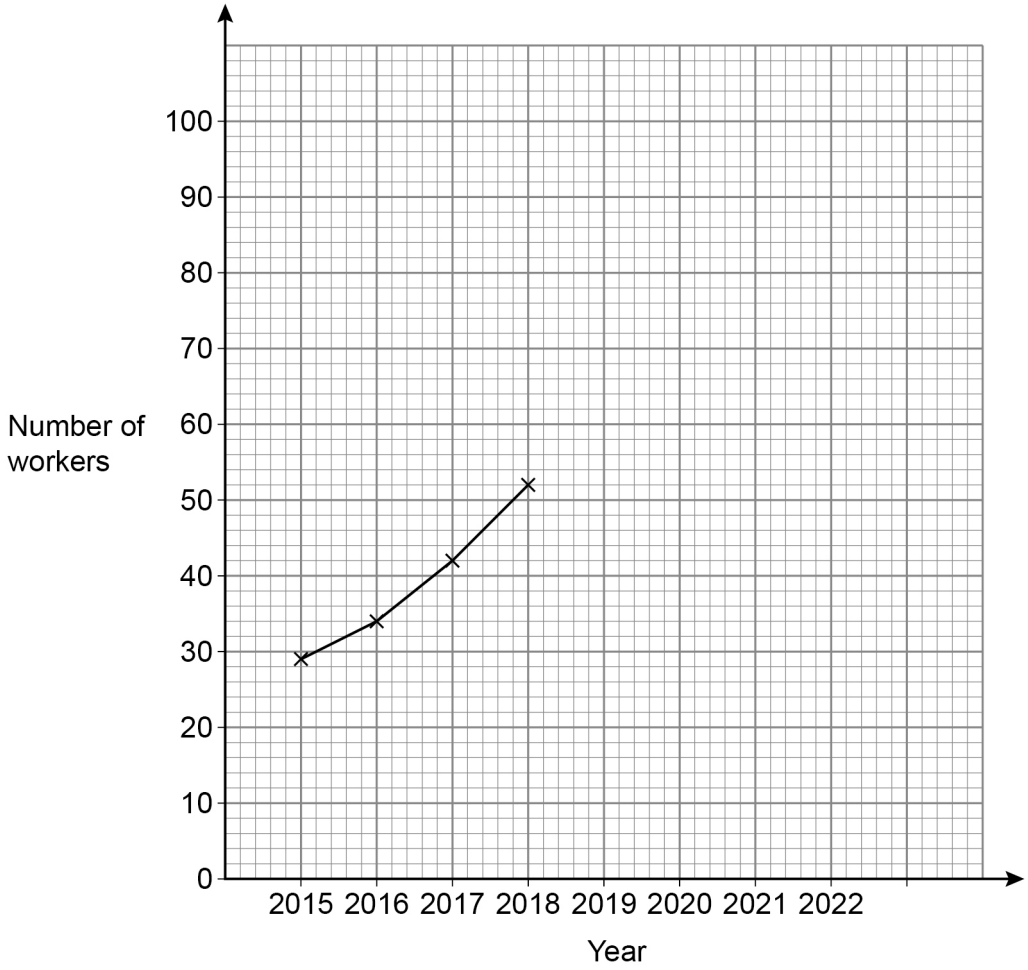

6 (a) Complete the graph.

[2 marks]

6 (b) Estimate the number of workers at the company in 2023

[1 mark]

Answer _____

7

Turn over ►

Do not write outside the box

7 Here is a cone.

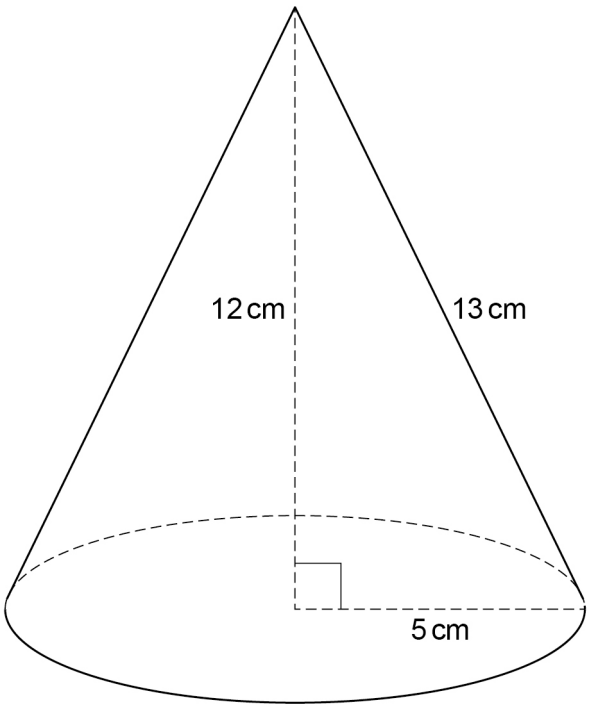

7 (a)

Curved surface area of a cone $= \pi r l$

where r is the radius and l is the slant height

Beth tries to work out the curved surface area in terms of π

Curved surface area of the cone $= \pi \times 5 \times 12$

$= 60\pi \text{ cm}^2$

What mistake has she made?

[1 mark]

Do not write outside the box

7 (b) Adam uses $\pi = 3$ to estimate the area of the **base** of the cone.

Work out his estimate.

[2 marks]

Answer _____ cm^2

7 (c) Beth uses $\pi = 3.14$ to estimate the area of the **base** of the cone.

Is Beth's estimate more than or less than Adam's estimate?

Tick a box.

More than ☐ Less than ☐

Give a reason for your answer.

[1 mark]

Turn over for the next question

4

Do not write outside the box

8 Solve $7x - 22 = 4x + 29$

[3 marks]

$x =$ _____

9 In a house

the floor area of the living room is $26\,\text{m}^2$

the floor area of the kitchen is $16.4\,\text{m}^2$

Express the area of the living room as a fraction of the area of the kitchen.
Give your answer in its simplest form.

[3 marks]

Answer _____

Do not write outside the box

10 (a) Represent $-2 < x < 4$ on the number line.

[1 mark]

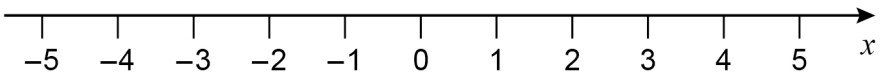

10 (b) Solve $5y + 14 \geqslant 11$

[2 marks]

Answer _____

Turn over for the next question

9

Do not write outside the box

11

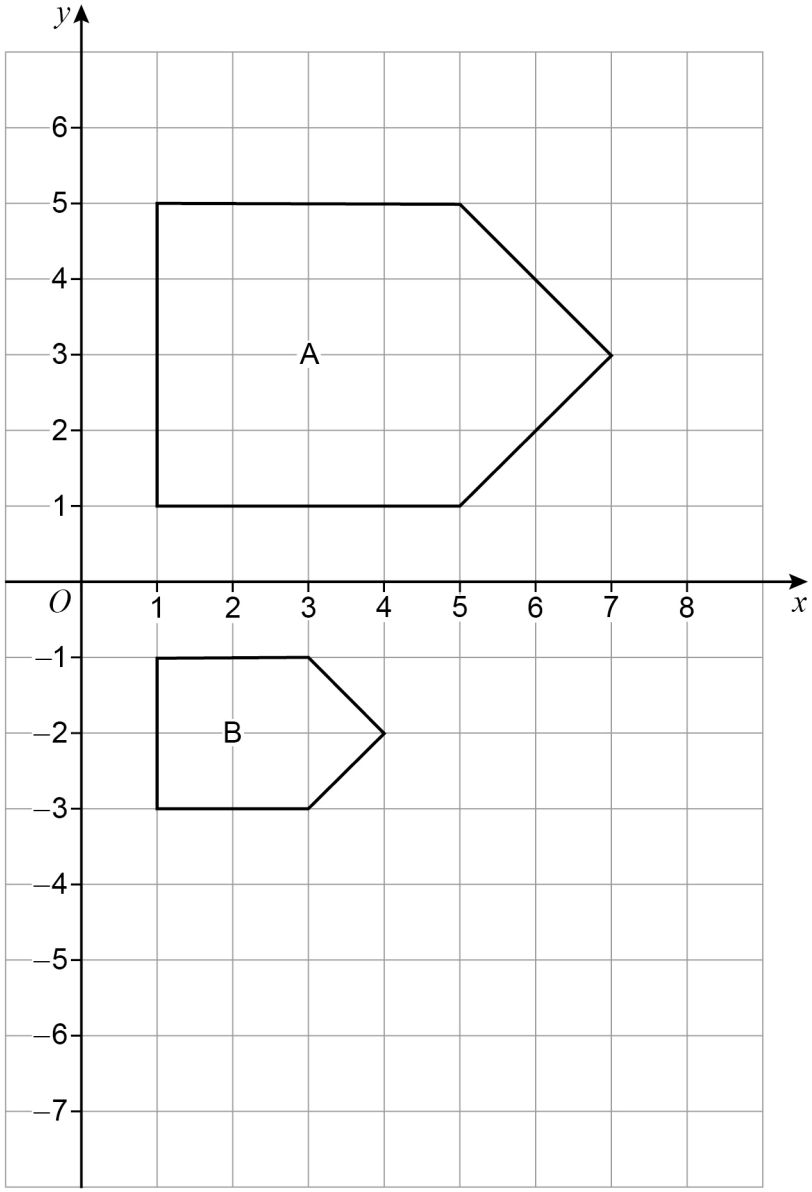

Describe fully the **single** transformation that maps shape A to shape B.

[3 marks]

Do not write outside the box

12 A sector has radius 12 cm and angle 60°

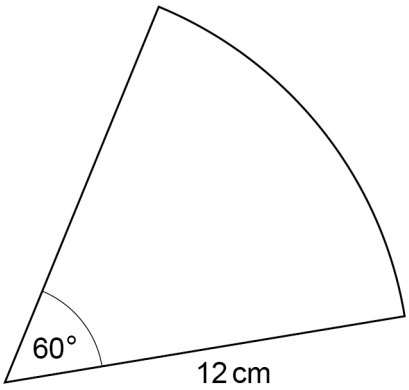

Not drawn accurately

Work out the length of the arc.

Give your answer in terms of π

[3 marks]

Answer _____ cm

Turn over for the next question

6

Do not write outside the box

13 *ABCDE* is a pentagon with $AB = 7$ cm

- $BC = 6$ cm
- *AB* and *BC* are perpendicular.
- *AB* and *DC* are equal **and** parallel.
- Area of the pentagon $= 54\ \text{cm}^2$
- The pentagon has exactly **one** line of symmetry.

Complete a **labelled** drawing of the pentagon.

[4 marks]

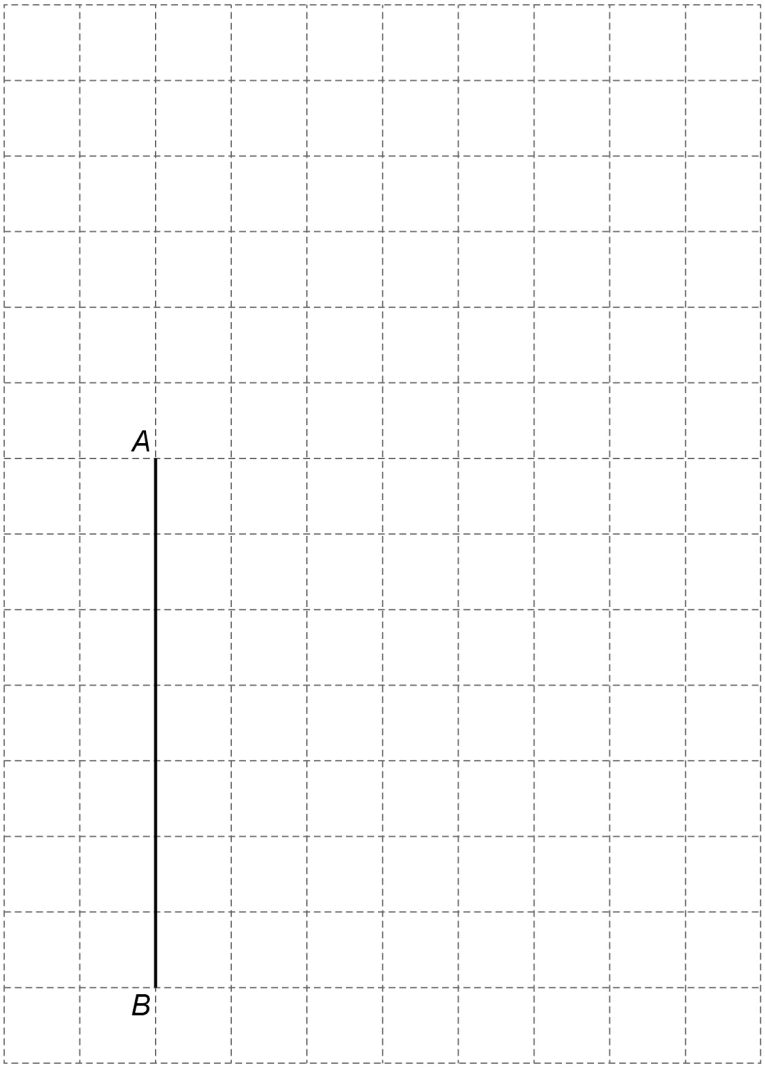

Do not write outside the box

14 4 chocolate bars and 3 packets of mints cost £4.70

5 chocolate bars and 1 packet of mints cost £4.50

Work out the cost of a chocolate bar and the cost of a packet of mints.

[4 marks]

chocolate bar _____

packet of mints _____

Turn over for the next question

8

Do not write outside the box

15 (a) Between which two **consecutive** integers does the square root of 210 lie?

[1 mark]

Answer _____ and _____

15 (b) Here are two calculations, A and B.

A	**B**
$1.92^7 + 6.9^3$	$5 \times \sqrt[3]{1\,000\,350}$

Use approximations to show that answer to A < answer to B

[3 marks]

Do not write outside the box

16 The table shows information about the ages of members of two clubs.

	Median age (years)	**Interquartile range of ages (years)**
Swimming club	21.2	7.3
Cycling club	29.7	4.6

Compare the average age and consistency of ages for the members of the two clubs.

[2 marks]

Average _____

_____

_____

Consistency _____

_____

_____

Turn over for the next question

6

Do not write outside the box

17 Rearrange $y = \dfrac{3x+7}{x}$ to make x the subject.

[4 marks]

Answer _____

Do not write outside the box

18 A circle has centre O and passes through (0, 6)

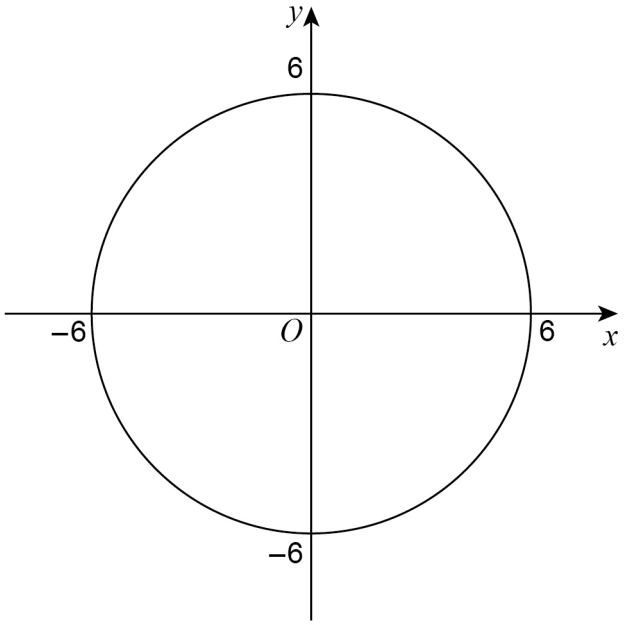

Write down the equation of the circle.

[1 mark]

Answer _____

Turn over for the next question

5

Do not write outside the box

19 A, B and C are numbers.

Here is some information about B and C.

$\boldsymbol{B}$	$\frac{7}{4}$ of A
$\boldsymbol{C}$	A **increased** by 150%

Work out C as a fraction of B.

[4 marks]

Answer _____

Do not write outside the box

20 $5x^3 + ax^2 + bx + c \equiv kx^3 + (2 - k)x^2 + (a^2 - 1)\,x + \dfrac{b}{2}$

Work out the values of a, b and c.

[3 marks]

$a =$ _____ $b =$ _____ $c =$ _____

Turn over for the next question

7

Do not write outside the box

21 Prove algebraically that $1.0\dot{1}\dot{8} = \frac{56}{55}$

[3 marks]

Do not write outside the box

22 *A*, *B* and *C* are points on a circle, centre *O*.

AP and *BP* are tangents to the circle.

Not drawn accurately

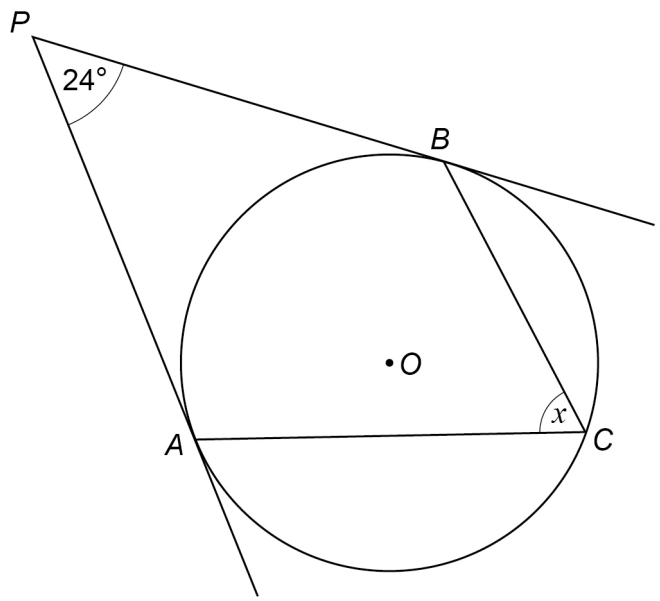

Work out the size of angle x.

[3 marks]

Answer _____ °

6

Turn over ►

Do not write outside the box

23 (a) The first three terms of a geometric progression are $\frac{\sqrt{5}}{2}$ $\frac{5}{4}$ $\frac{5\sqrt{5}}{8}$

Work out the next term.

[1 mark]

Answer _____

23 (b) The nth term of a sequence is $(2+\sqrt{3})^n$

Show that the third term is $26+15\sqrt{3}$

[3 marks]

Do not write outside the box

24 (a) $9k + 7$ and $2k^2 + 3$ are consecutive integers.

$9k + 7$ is the smaller integer.

Work out the value of the **next** consecutive integer.

[5 marks]

Answer _____

24 (b) x is a square number.

Show that the **next** square number is $x + 2\sqrt{x} + 1$

[2 marks]

11

Turn over ►

Do not write outside the box

25 Show that the value of $6 \sin 30° + 2 \cos 30° \times 4 \tan 30°$ is an integer.

[4 marks]

END OF QUESTIONS

4

Do not write outside the box

There are no questions printed on this page

DO NOT WRITE ON THIS PAGE
ANSWER IN THE SPACES PROVIDED

Do not write outside the box

Question number	**Additional page, if required.** **Write the question numbers in the left-hand margin.**

Do not write outside the box

Question number	**Additional page, if required.** **Write the question numbers in the left-hand margin.**

Do not write outside the box

Question number	**Additional page, if required.** **Write the question numbers in the left-hand margin.**

Copyright information

For confidentiality purposes, all acknowledgements of third-party copyright material are published in a separate booklet. This booklet is published after each live examination series and is available for free download from www.aqa.org.uk.

Permission to reproduce all copyright material has been applied for. In some cases, efforts to contact copyright-holders may have been unsuccessful and AQA will be happy to rectify any omissions of acknowledgements. If you have any queries please contact the Copyright Team.

Copyright © 2024 AQA and its licensors. All rights reserved.