Please write clearly in block capitals.

Centre number | | | | | | Candidate number | | | | |

Surname _____

Forename(s) _____

Candidate signature _____
I declare this is my own work.

GCSE
MATHEMATICS

H

Higher Tier Paper 1 Non-Calculator

Tuesday 1 November 2022 Morning Time allowed: 1 hour 30 minutes

Materials

For this paper you must have:
- mathematical instruments
- the Formulae Sheet (enclosed).

You must **not** use a calculator.

Instructions

- Use black ink or black ball-point pen. Draw diagrams in pencil.
- Fill in the boxes at the top of this page.
- Answer **all** questions.
- You must answer the questions in the spaces provided. Do not write outside the box around each page or on blank pages.
- If you need extra space for your answer(s), use the lined pages at the end of this book. Write the question number against your answer(s).
- Do all rough work in this book. Cross through any work you do not want to be marked.

Information

- The marks for questions are shown in brackets.
- The maximum mark for this paper is 80.
- You may ask for more answer paper, graph paper and tracing paper. These must be tagged securely to this answer book.

Advice

In all calculations, show clearly how you work out your answer.

For Examiner's Use	
Pages	Mark
2–3	
4–5	
6–7	
8–9	
10–11	
12–13	
14–15	
16–17	
18–19	
20–21	
22	
TOTAL	

Do not write outside the box

Answer **all** questions in the spaces provided.

1 Work out $-4 \times -\frac{7}{9}$

Circle your answer.

[1 mark]

$-\frac{28}{36}$ $-\frac{28}{9}$ $\frac{28}{36}$ $\frac{28}{9}$

2 Circle the value of $\left(\sqrt{6}\right)^4$

[1 mark]

12 36 10 $\sqrt{24}$

3 $0.203 = \frac{1}{5} + x$

Circle the value of x.

[1 mark]

$\frac{1}{300}$ $\frac{1}{3000}$ $\frac{3}{100}$ $\frac{3}{1000}$

Do not write outside the box

4 Circle the correct statement.

[1 mark]

$3x \equiv x + 2x$ $\quad$ $3x \equiv 2$ $\quad$ $3x + x \equiv 2 - x$ $\quad$ $3x + x - 2 \equiv 0$

5 Divide 62 in the ratio 3 : 7

[3 marks]

Answer _____ and _____

Turn over for the next question

7

Do not write outside the box

6 Here is some information about the time spent on social media by 40 women and 40 men last week.

Time spent, t (hours)	Number of women	Number of men
$2 < t \leqslant 5$	12	10
$5 < t \leqslant 8$	11	17
$8 < t \leqslant 11$	14	9
$11 < t \leqslant 14$	2	4
$14 < t \leqslant 17$	1	0

Tick **one** box for each statement.

[3 marks]

	Definitely true	Might be true	Cannot be true
Three of the **women** spent more than 11 hours on social media.	☐	☐	☐
The range for the **men** is 15 hours.	☐	☐	☐
The women have a higher median than the men.	☐	☐	☐

Do not write outside the box

7 The diagram shows the vectors **a** and **b**.

As a column vector $\mathbf{a} = \begin{pmatrix} 3 \\ 2 \end{pmatrix}$

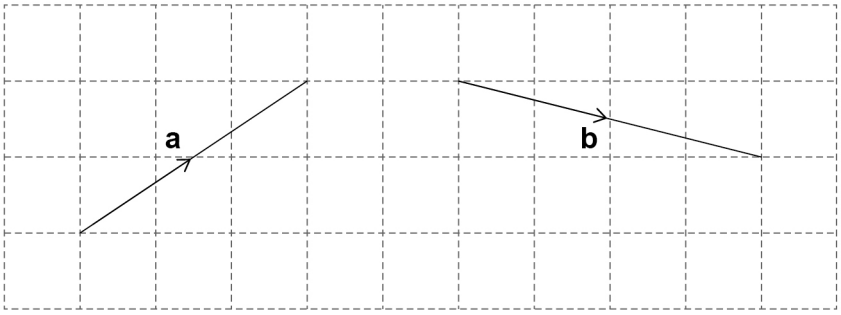

7 (a) What is **b** as a column vector?

[2 marks]

Answer $\begin{pmatrix} \quad \\ \quad \end{pmatrix}$

7 (b) Work out 4**a** as a column vector.

[1 mark]

Answer $\begin{pmatrix} \quad \\ \quad \end{pmatrix}$

7 (c) $\mathbf{a} + \mathbf{c} = \begin{pmatrix} 3 \\ 0 \end{pmatrix}$

Work out **c** as a column vector.

Circle your answer.

[1 mark]

$\begin{pmatrix} 2 \\ 0 \end{pmatrix}$ $\begin{pmatrix} 0 \\ 2 \end{pmatrix}$ $\begin{pmatrix} -2 \\ 0 \end{pmatrix}$ $\begin{pmatrix} 0 \\ -2 \end{pmatrix}$

7

Do not write outside the box

8 Work out $\left(\frac{7}{10} - \frac{4}{15}\right) \div \frac{2}{3}$

Give your answer as a fraction.

[3 marks]

Answer _____

9 Work out all the **integer** values of x for which $12 \leqslant 4x < 25$

[2 marks]

Answer _____

Do not write outside the box

10 Here is some information about 120 people who visit a shop.

$\frac{3}{4}$ of the people buy neither a coat nor a dress.

19 people buy a coat.

14 people buy a dress.

Complete this Venn diagram to represent the information.

[3 marks]

ξ = 120 people who visit the shop

C = people who buy a coat

D = people who buy a dress

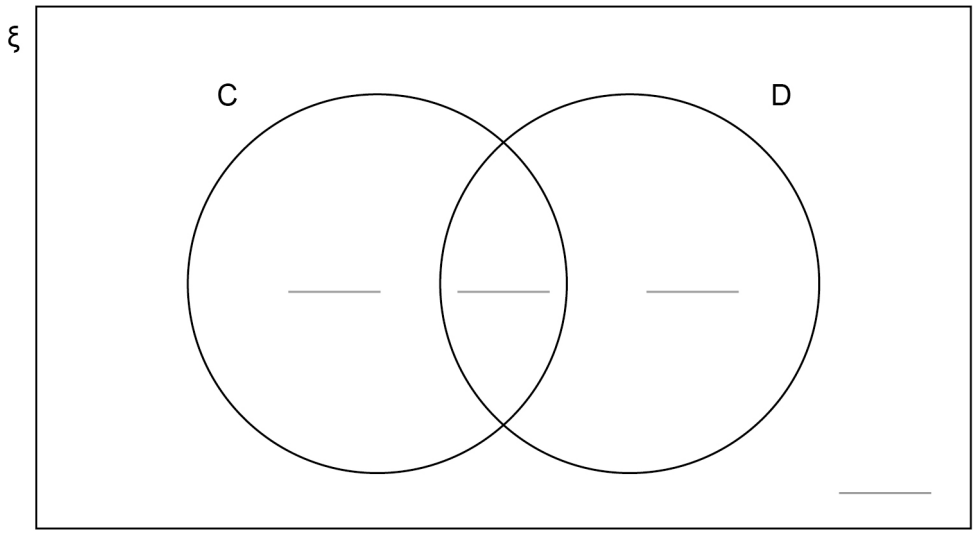

8

Do not write outside the box

11 Write $(3^6 \times 3^5) : 3^7$ in the form $n : 1$ where n is an integer.

[3 marks]

Answer _____ : 1

12 a is 10% more than b.

Circle the ratio $a : b$

[1 mark]

10 : 11 10 : 1 11 : 10 1 : 10

13 Work out $0.4\dot{7} + 0.312$

Circle your answer.

[1 mark]

0.782 0.789 $0.789\dot{7}$ $0.7\dot{8}\dot{9}$

Do not write outside the box

14 Craig wants to draw a graph, for values of x from -3 to 3,

where the x-coordinate and y-coordinate are always in the ratio 2 : 1

Here is his graph.

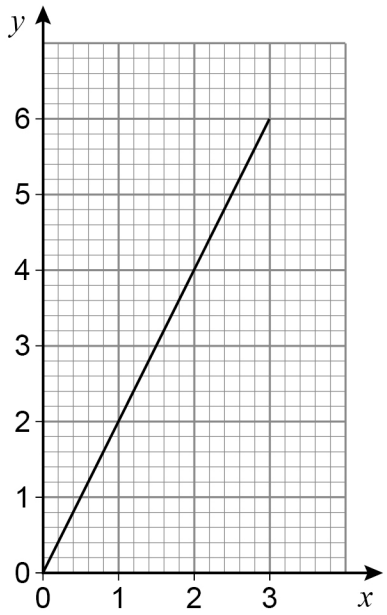

Make two criticisms of Craig's graph.

[2 marks]

Criticism 1 _____

_____

_____

Criticism 2 _____

_____

_____

7

Turn over ►

Do not write outside the box

15 Show that $(3x + 4)(2x - 5) - 11x(x - 2) + 5(x^2 - 3x - 1)$ simplifies to an integer.

[4 marks]

Do not write outside the box

16 A graph has the equation $y = x^2 + px + r$ where p and r are constants.

The graph passes through the points (0, 4), (1, 3) and (8, w)

Work out the value of w.

[4 marks]

$w =$ _____

Turn over for the next question

8

Do not write outside the box

17 The table shows information about the heights of 60 athletes.

Height, h (cm)	**Frequency**
$150 < h \leqslant 160$	4
$160 < h \leqslant 170$	12
$170 < h \leqslant 180$	35
$180 < h \leqslant 190$	7
$190 < h \leqslant 200$	2

17 (a) Complete the cumulative frequency table.

[1 mark]

Height, h (cm)	**Cumulative frequency**
$h \leqslant 150$	0
$h \leqslant 160$	4
$h \leqslant 170$	16
$h \leqslant 180$	
$h \leqslant 190$	
$h \leqslant 200$	

17 (b) Circle the class interval that contains the lower quartile.

[1 mark]

$150 < h \leqslant 160$ $160 < h \leqslant 170$ $170 < h \leqslant 180$ $180 < h \leqslant 190$

Do not write outside the box

17 (c) Draw a cumulative frequency diagram to represent the data.

[2 marks]

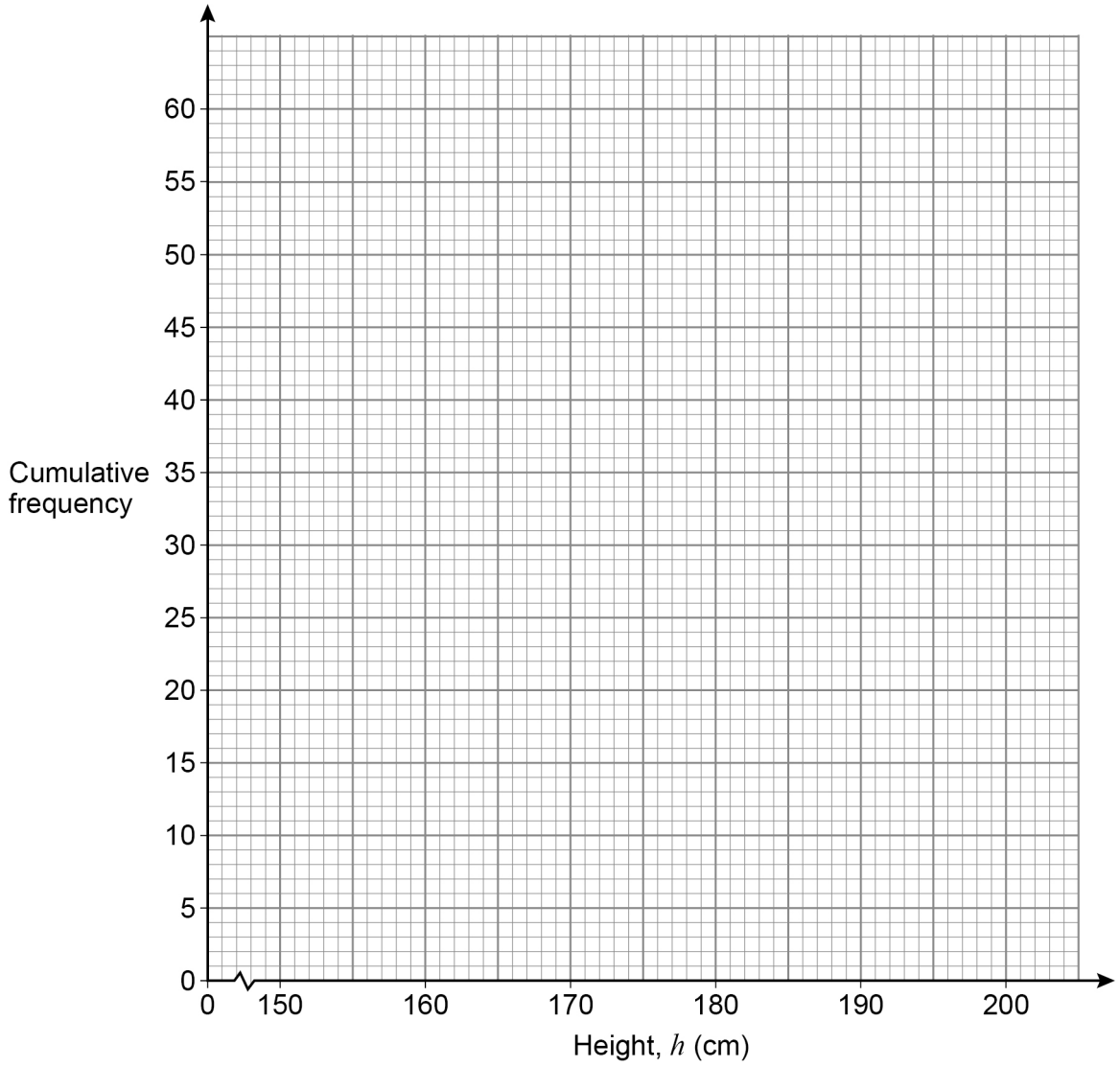

17 (d) Estimate the number of the athletes whose height is **more** than 176 cm

[2 marks]

Answer _____

6

Turn over ►

Do not write outside the box

18 A road has three sections, D, E and F.

The lengths of D, E and F are in the ratios

D : E = 3 : 5 E : F = 7 : 4

What fraction of the length of the road is section D?

[3 marks]

Answer _____

Do not write outside the box

19 (a) Work out the value of $\left(\frac{5}{4}\right)^{-2}$

[2 marks]

Answer _____

19 (b) Work out the value of $\left(\frac{9}{100}\right)^{\frac{3}{2}}$

[2 marks]

Answer _____

Turn over for the next question

7

Do not write outside the box

20 The only solution to $x^2 + bx + c = 0$ is $x = -15$

Work out the values of b and c.

[3 marks]

$b =$ _____ $c =$ _____

21 Convert $0.6\dot{1}$ to a fraction.

[3 marks]

Answer _____

Do not write outside the box

22 (4, 8) is a point on a circle, centre O.

The tangent at (4, 8) intersects the x-axis at P.

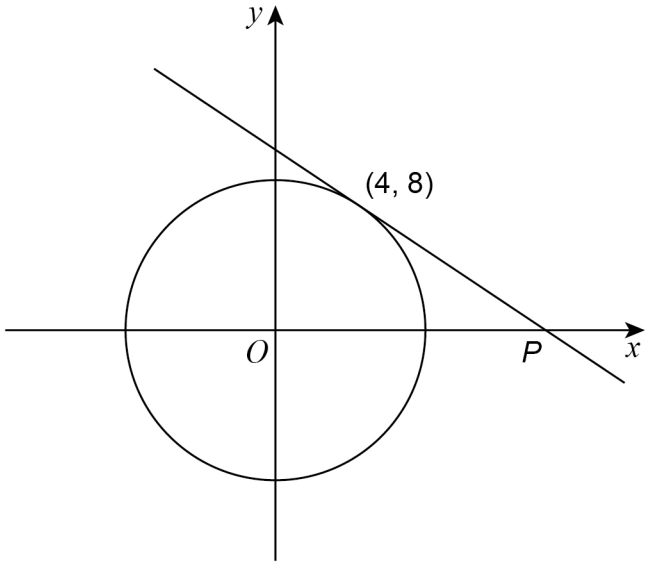

Not drawn accurately

Work out the x-coordinate of P.

[5 marks]

Answer _____

11

Turn over ►

Do not write outside the box

23 $4 \times \sin 30° \times \tan 30° \times \cos 30° = \sin y$

Work out **one** possible value of y.

You **must** show your working.

[4 marks]

Answer _____ degrees

Do not write outside the box

24 Triangle *ABC* is drawn on a grid.

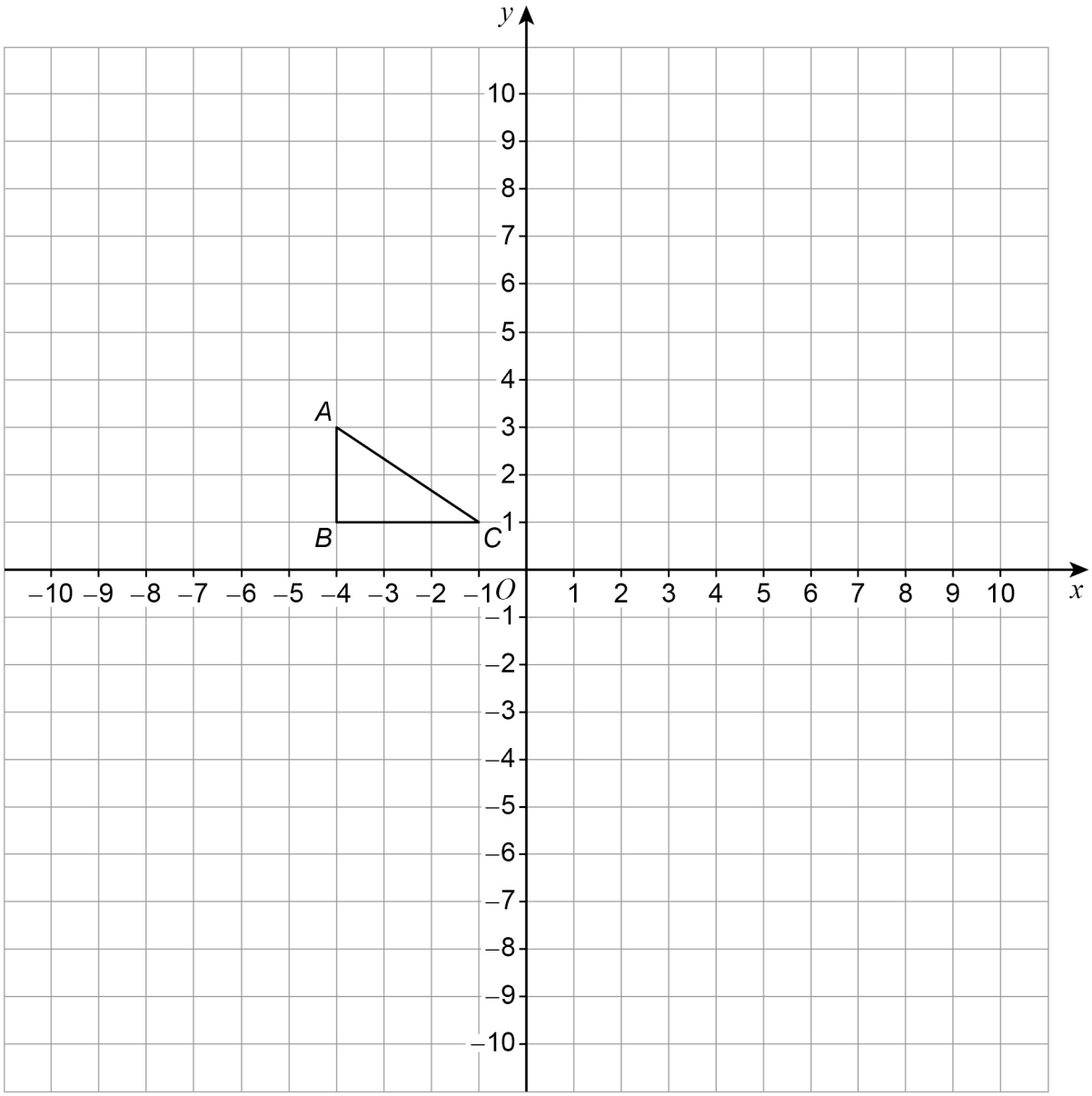

ABC is transformed to *A*'*B*'*C*' by a reflection in the line $x = 1$

A'*B*'*C*' is transformed to *A*''*B*''*C*'' by a rotation 90° anticlockwise about (1, –4)

Which **one** point on *ABC* is invariant under the combined transformation?
You **must** show the result of each transformation on the grid.

[4 marks]

Answer _____

8

Turn over ►

Do not write outside the box

25 (a) Solve $x^2 - 5x - 6 < 0$

[2 marks]

Answer _____

25 (b) Show the solution to $x^2 - 5x - 6 < 0$ on the number line.

[1 mark]

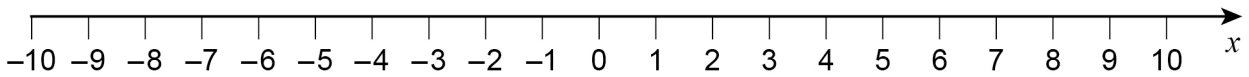

Do not write outside the box

26 P, Q and R are points on a circle.

SP is a tangent to the circle.

$RQ = PQ$

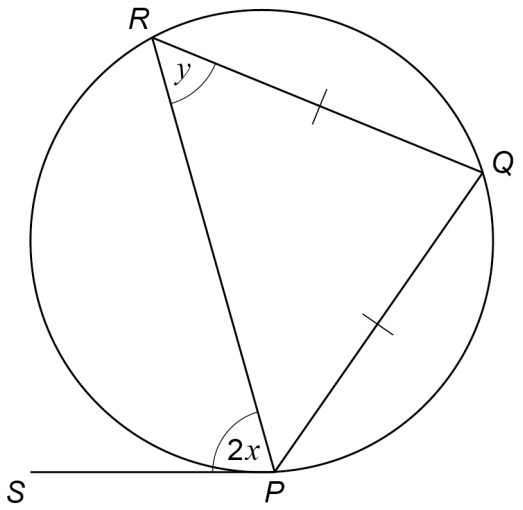

Not drawn accurately

Prove that $y = 90° - x$

[4 marks]

7

Turn over ►

Do not write outside the box

27 Work out $\sqrt{2\frac{13}{16}} - \frac{2}{\sqrt{5}}$

Give your answer in the form $\frac{a\sqrt{5}}{b}$ where a and b are integers.

[4 marks]

Answer _____

END OF QUESTIONS

4

Do not write outside the box

There are no questions printed on this page

DO NOT WRITE ON THIS PAGE
ANSWER IN THE SPACES PROVIDED

Do not write outside the box

Question number	**Additional page, if required.** **Write the question numbers in the left-hand margin.**

Do not write outside the box

Question number	**Additional page, if required.** **Write the question numbers in the left-hand margin.**

Do not write outside the box

Question number	**Additional page, if required.** **Write the question numbers in the left-hand margin.**

Do not write outside the box

Question number	**Additional page, if required.** **Write the question numbers in the left-hand margin.**

Do not write outside the box

There are no questions printed on this page

DO NOT WRITE ON THIS PAGE
ANSWER IN THE SPACES PROVIDED

Copyright information

For confidentiality purposes, all acknowledgements of third-party copyright material are published in a separate booklet. This booklet is published after each live examination series and is available for free download from www.aqa.org.uk.

Permission to reproduce all copyright material has been applied for. In some cases, efforts to contact copyright-holders may have been unsuccessful and AQA will be happy to rectify any omissions of acknowledgements. If you have any queries please contact the Copyright Team.

Copyright © 2022 AQA and its licensors. All rights reserved.